DAY — 07 SEAT NUMBER | | | | | | |

2025	II	18	1100	J-297	(E)

HOME MANAGEMENT (61)

Time : 3 Hrs. **(7 Pages)** **Max. Marks : 70**

Note : *(1) All questions are compulsory.*

(2) Figures given to the right indicate full marks.

(3) Write answers of all questions on new pages.

Q. 1. **(A)** Rewrite the sentences by choosing the most appropriate answers from the given alternatives : (6) **[18]**

(1) In time management process goal setting is the _____ step.

(a) second

(b) first

(c) third

(2) Energy means ability of a person to do _____.

(a) physical work

(b) mental work

(c) physical and mental work

(3) In 1879, the incandescent bulb was invented by _____.

(a) Thomas Edison

(b) James Maxwell

(c) Michael Faraday

(4) This family income is considered as regular and fixed source of income –

(a) shares

(b) dividend

(c) salary

(5) This is an example of UPI –

(a) BHIM

(b) NEFT

(c) RTGS

(6) Script of motion and time study is termed as ____.

(a) Gilbreth

(b) Therblig

(c) Operation chart

(B) Match the words from Group 'A' with Group 'B' : (6)

Group 'A'		Group 'B'	
(a)	Decorative accessories	(1)	Record the time
(b)	Rajasthan	(2)	Geometric design
(c)	Mental effort	(3)	Wall hanging
(d)	Stop watch	(4)	Mandana
(e)	Starch in milk	(5)	Alpana
(f)	Pattern	(6)	Studying
		(7)	Adulteration

(C) Do as directed : (6)

(1) Complete the diagram :

Primary colours

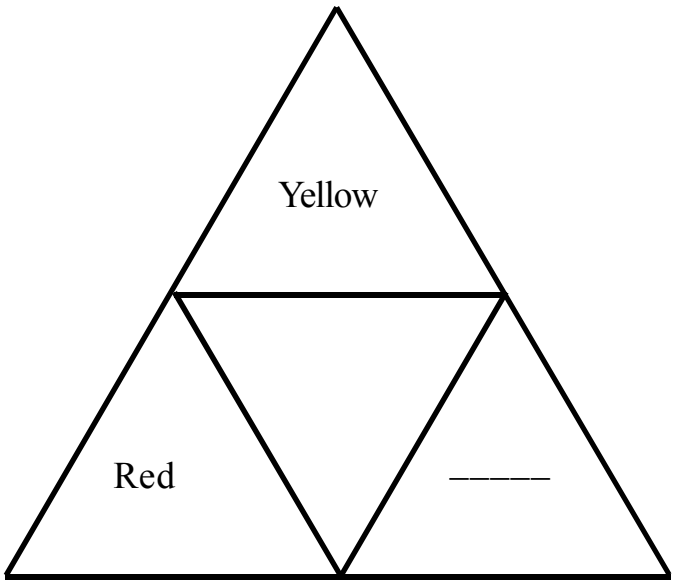

(2) State whether the given statement is 'true' or 'false' :

Budget is not a type of household account.

(3) By considering the first correlation complete the second correlation :

Clock time : Study hours : : Leisure time : _____

(4) Find out the odd words :

(a) Brand label

(b) Grade label

(c) Consumer protection

(d) Descriptive label

(e) Informative label

(5) Unscramble the underlined word:

Accessories have N A L F U T I O C N as well as aesthetic value.

(6) Who am I?

Hint : In my design some traditional symbol like go-padam, shankh, chakra, etc. are used.

Q. 2. (A) Answer Any Six of the following : (12) **[16]**

(1) Explain rhythm in work.

(2) Explain home scale and small scale industry.

(3) Explain the term leisure time.

(4) Complete the flow chart :

Voluntary saving schemes

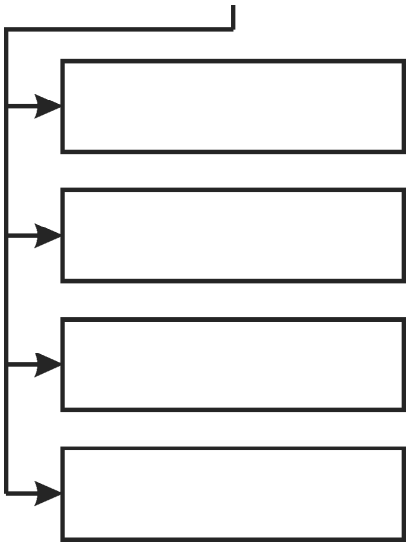

(5) How will you take care of wood and glass material?

(6) Identify the given picutre and explain it.



(7) Write advantages of solar energy.

(B) Answer in brief (Any Two) : (4)

(1) Give reason : Time is fleeting.

(2) Explain : Evaluation.

(3) Write importance of space.

Q. 3. **(A)** Attempt Any Four of the following : (12) **[18]**

(1) Write functions of label.

(2) Differentiate between :

Psychological fatigue and Physiological fatigue.

(3) Identify the given picture and explain it :



(4) What are the ways to increase the family income by curtailing the expenditure?

(5) Explain rangoli on water.

(B) Write short notes (Any Two) : (6)

(1) Management process of human energy

(2) Real income

(3) Credit card

Q. 4. Answer the following questions : [18]

(A) (1) Define : Consumer. (1) **(6)**

(2) Write guidelines for wise purchase. (5)

OR

Describe various types of colour schemes.

(B) (1) Define : Account keeping. (1) **(6)**

(2) Explain methods of account keeping. (5)

OR

Explain characteristics of time.

(C) Explain application of Mundel's classes of change in household activities. (6)

OR

Explain the following important accessories and their care :

(1) Pictures

(2) Flower vase

(3) Indoor plants

◆◆◆